Function Machines (Add & Subtract) Name:

**Determine the rule each function machine is using.**

**Ex)**

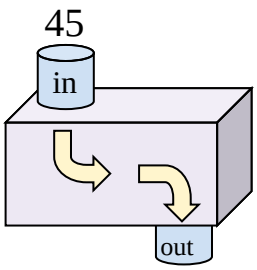


Subtract 32

**1)**

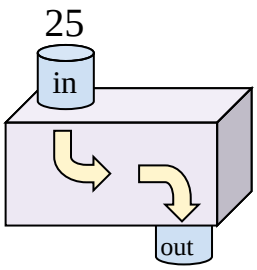


**2)**

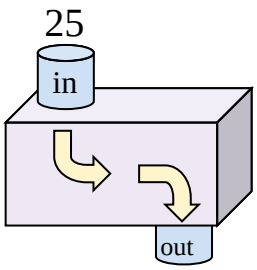


**3)**

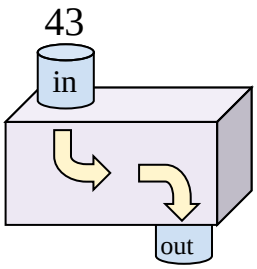


**4)**

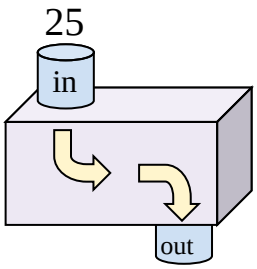


**5)**

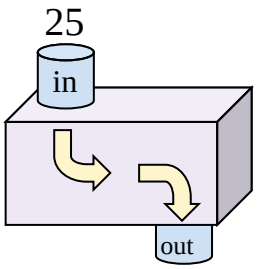


**6)**

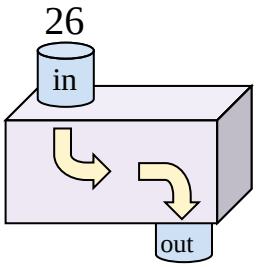


**7)**

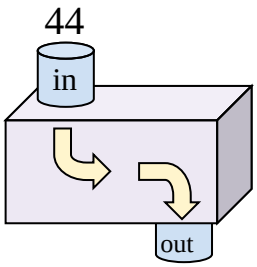


**8)**

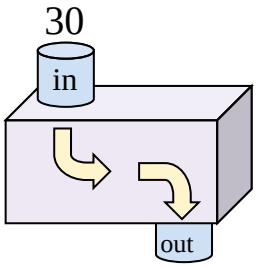


**9)**

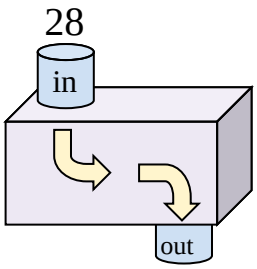


**10)**

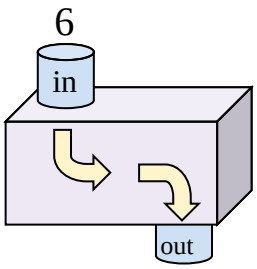


**11)**

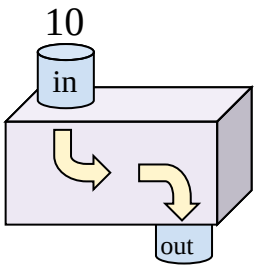


## Answers

Ex. Subtract 32

1. _____
2. _____
3. _____
4. _____
5. _____
6. _____
7. _____
8. _____
9. _____
10. _____
11. _____

Function Machines (Add & Subtract) Name: **Answer Key**

**Determine the rule each function machine is using.**

**Ex)**

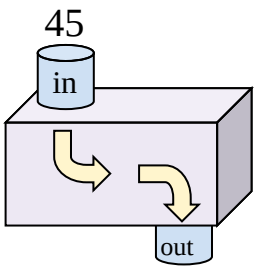


Subtract 32

**1)**

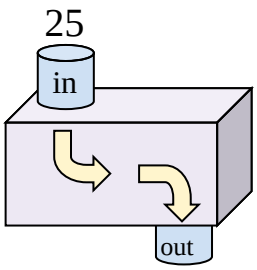


Add 5

**2)**

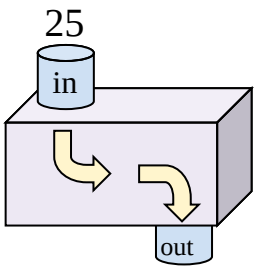


Subtract 7

**3)**

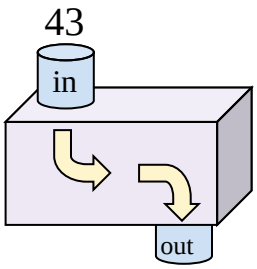


Subtract 22

**4)**

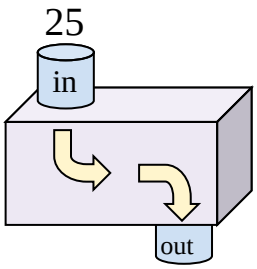


Add 25

**5)**

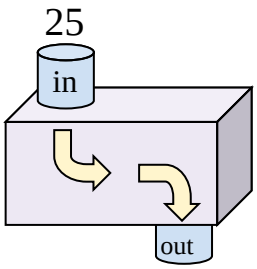


Add 12

**6)**

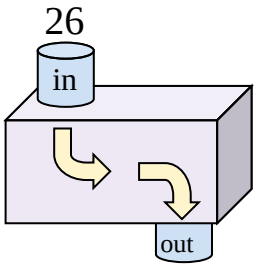


Add 23

**7)**

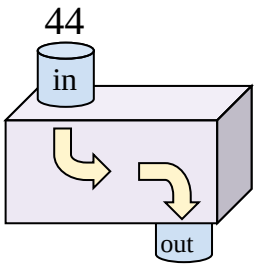


Subtract 20

**8)**

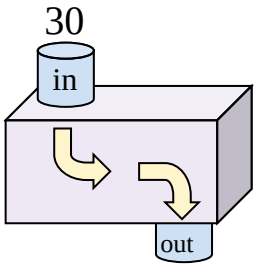


Add 7

**9)**

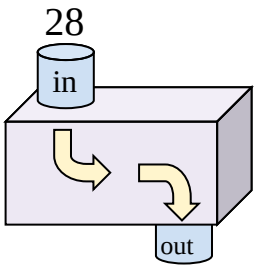


Subtract 14

**10)**

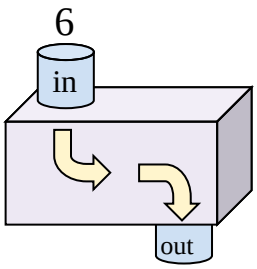


Add 33

**11)**

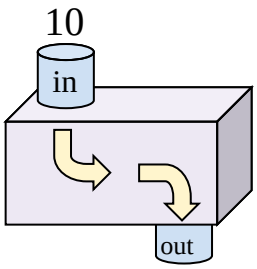


Add 30

## Answers

| | |
|---|---|
| Ex. | Subtract 32 |
| 1. | Add 5 |
| 2. | Subtract 7 |
| 3. | Subtract 22 |
| 4. | Add 25 |
| 5. | Add 12 |
| 6. | Add 23 |
| 7. | Subtract 20 |
| 8. | Add 7 |
| 9. | Subtract 14 |
| 10. | Add 33 |
| 11. | Add 30 |