Function Machines (Add & Subtract) Name:

Determine the rule each function machine is using.

Ex)

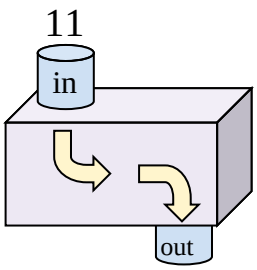

Add 20

1)

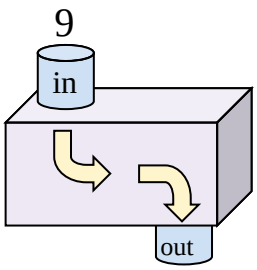

2)

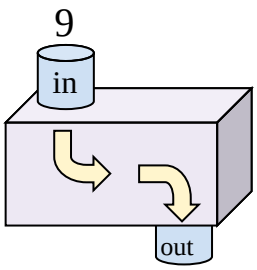

3)

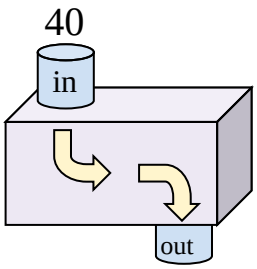

4)

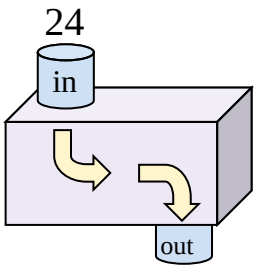

5)

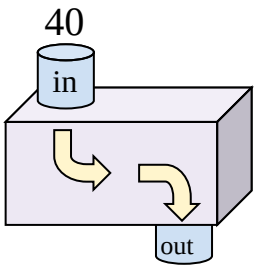

6)

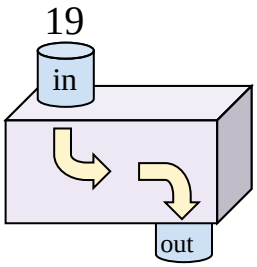

7)

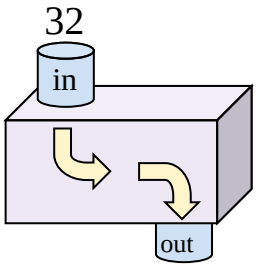

8)

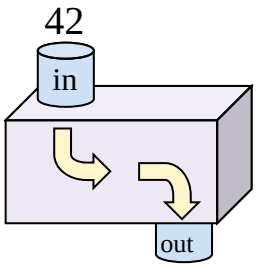

9)

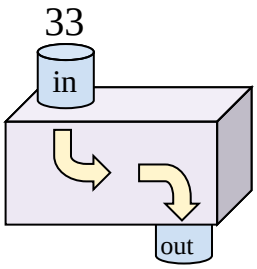

10)

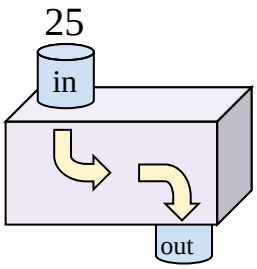

11)

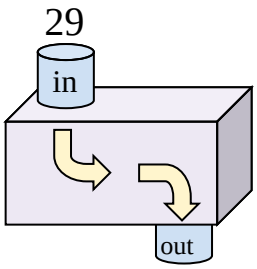

Answers

Ex. Add 20

1. _____
2. _____
3. _____
4. _____
5. _____
6. _____
7. _____
8. _____
9. _____
10. _____
11. _____

1-10	91	82	73	64	55	45	36	27	18	9
11	0									

Function Machines (Add & Subtract) Name: **Answer Key**

Determine the rule each function machine is using.

Ex)

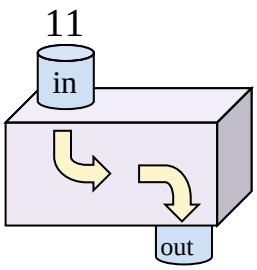

Add 20

1)

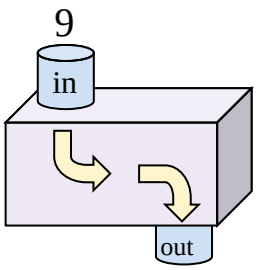

Add 27

2)

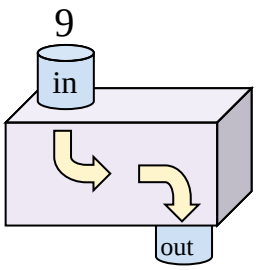

Add 25

3)

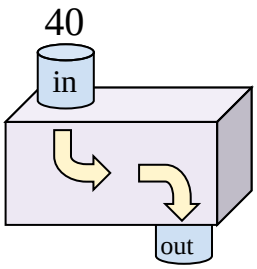

Subtract 28

4)

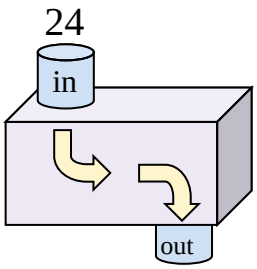

Subtract 6

5)

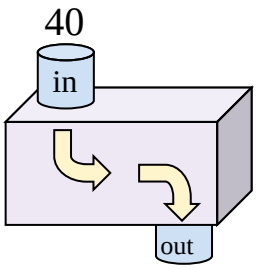

Subtract 34

6)

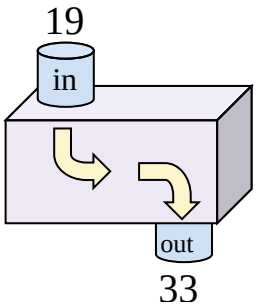

Add 14

7)

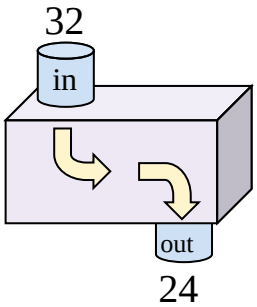

Subtract 8

8)

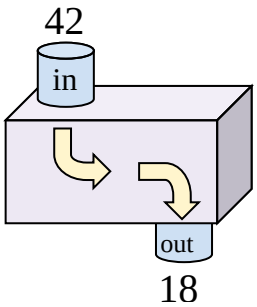

Subtract 24

9)

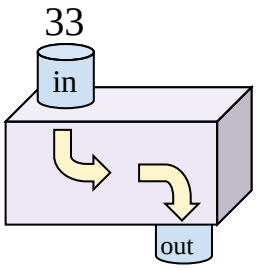

Subtract 25

10)

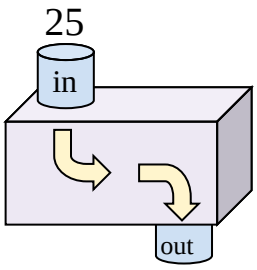

Add 14

11)

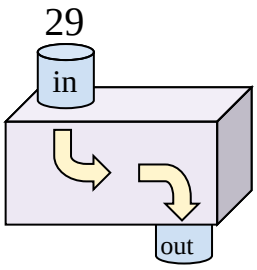

Add 9

Answers

Ex.	Add 20
1.	Add 27
2.	Add 25
3.	Subtract 28
4.	Subtract 6
5.	Subtract 34
6.	Add 14
7.	Subtract 8
8.	Subtract 24
9.	Subtract 25
10.	Add 14
11.	Add 9

1-10	91	82	73	64	55	45	36	27	18	9
11	0									