Rewriting Multiplication Problems (visual)

Name:

Write each array as a multiplication problem and solve.

Ex)

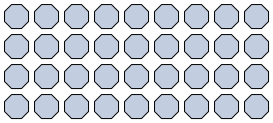

1)

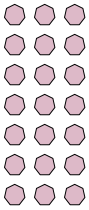

2)

3)



4)

5)



6)



7)



8)



9)

10)



11)



Answers

Ex. 4 × 9 = 36

1. _____
2. _____
3. _____
4. _____
5. _____
6. _____
7. _____
8. _____
9. _____
10. _____
11. _____

1-10	91	82	73	64	55	45	36	27	18	9
11	0									

Rewriting Multiplication Problems (visual) Name: **Answer Key**

Write each array as a multiplication problem and solve.

Ex) 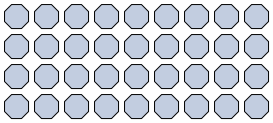

1) 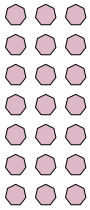

2)

3) 

4)

5) 

6) 

7) 

8) 

9)

10) 

11) 

Answers

Ex. 4 × 9 = 36

1. 7 × 3 = 21

2. 2 × 8 = 16

3. 6 × 10 = 60

4. 3 × 2 = 6

5. 10 × 7 = 70

6. 10 × 6 = 60

7. 3 × 5 = 15

8. 9 × 7 = 63

9. 3 × 6 = 18

10. 10 × 8 = 80

11. 7 × 7 = 49

1-10	91	82	73	64	55	45	36	27	18	9
11	0									