Dividing with a Numberline

Name:

Use the numberline to solve each problem.

1) 20÷4=

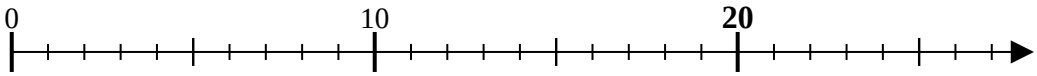

2) 18÷9=

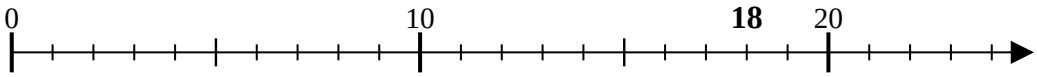

3) 10÷5=

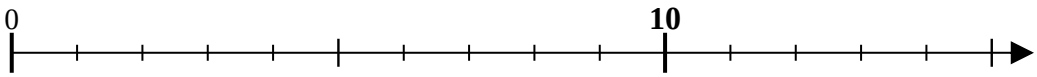

4) 10÷2=

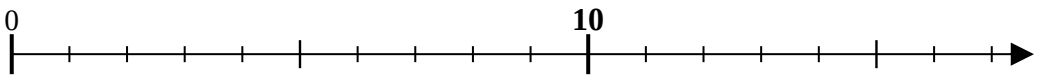

5) 4÷2=

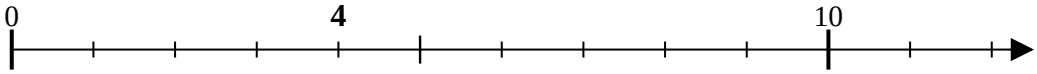

6) 35÷7=

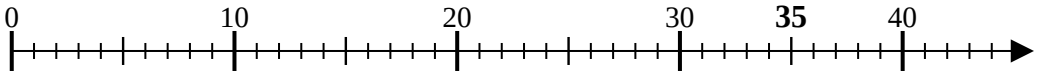

7) 30÷10=

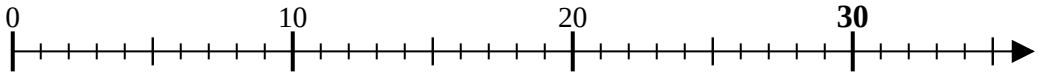

8) 20÷5=

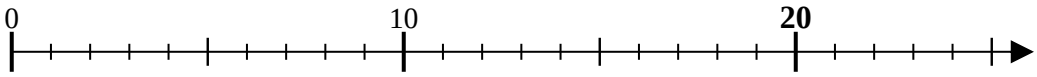

9) 24÷8=

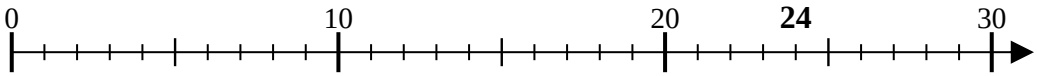

10) 15÷5=

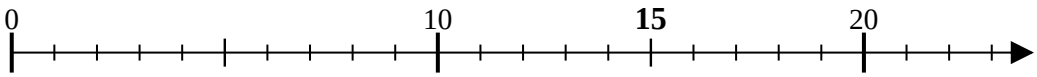

11) 36÷9=

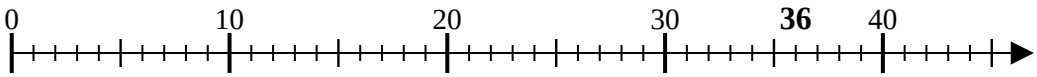

Answers

1. _____
2. _____
3. _____
4. _____
5. _____
6. _____
7. _____
8. _____
9. _____
10. _____
11. _____

1-10	91	82	73	64	55	45	36	27	18	9
11	0									

Dividing with a Numberline

Name: **Answer Key**

Use the numberline to solve each problem.

1) 20÷4=

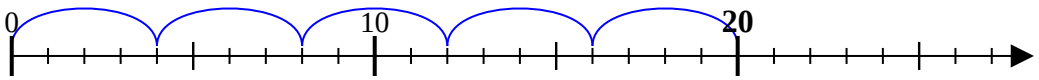

2) 18÷9=

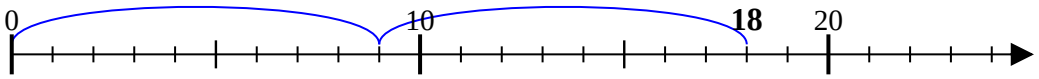

3) 10÷5=

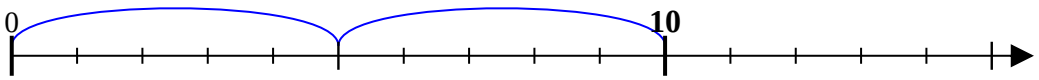

4) 10÷2=

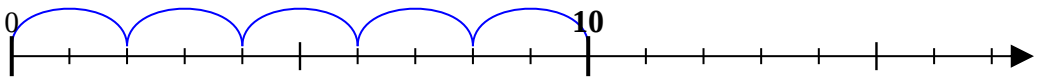

5) 4÷2=

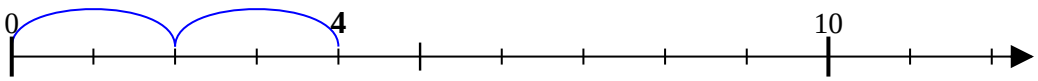

6) 35÷7=

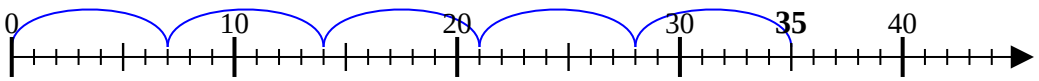

7) 30÷10=

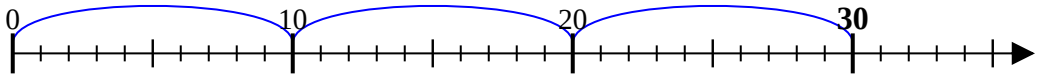

8) 20÷5=

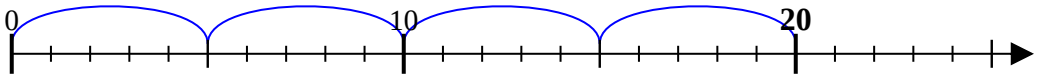

9) 24÷8=

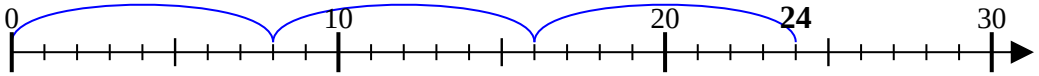

10) 15÷5=

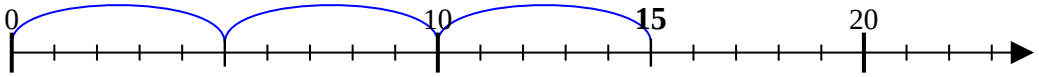

11) 36÷9=

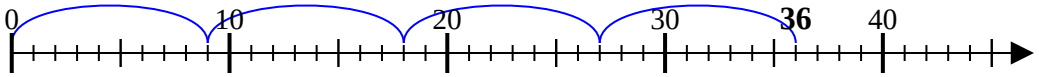

Answers

1. 5
2. 2
3. 2
4. 5
5. 2
6. 5
7. 3
8. 4
9. 3
10. 3
11. 4

1-10	91	82	73	64	55	45	36	27	18	9
11	0									