Dividing with a Numberline Name:

Use the numberline to solve each problem.

1) 24÷6=

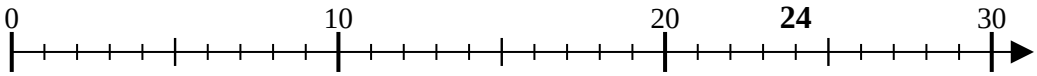

2) 16÷8=

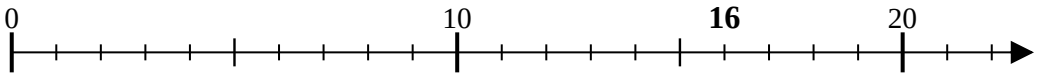

3) 10÷2=

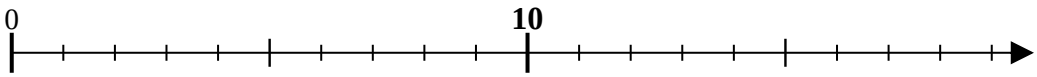

4) 40÷8=

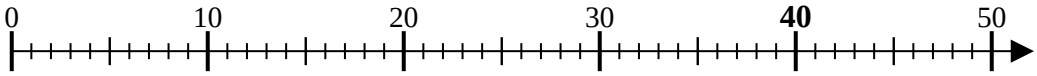

5) 6÷2=

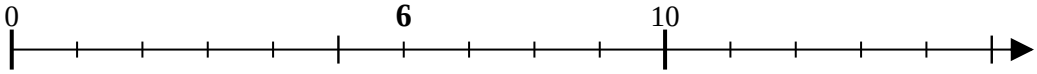

6) 40÷10=

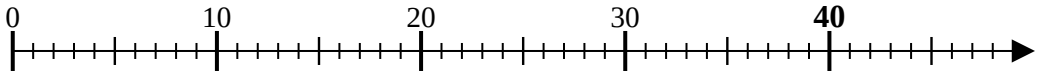

7) 15÷3=

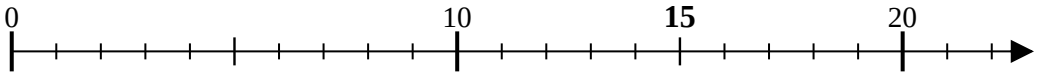

8) 18÷9=

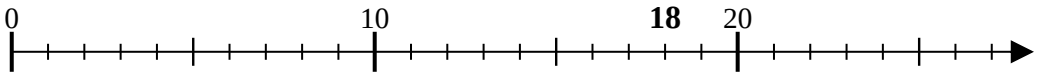

9) 27÷9=

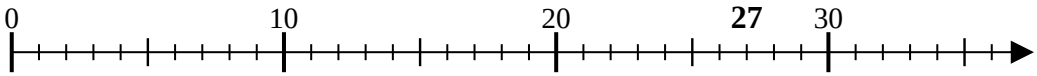

10) 36÷9=

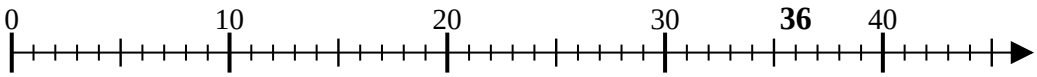

11) 8÷4=

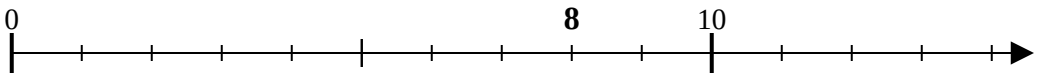

Answers

1. _____
2. _____
3. _____
4. _____
5. _____
6. _____
7. _____
8. _____
9. _____
10. _____
11. _____

1-10	91	82	73	64	55	45	36	27	18	9
11	0									

Dividing with a Numberline

Name: **Answer Key**

Use the numberline to solve each problem.

1) 24÷6=

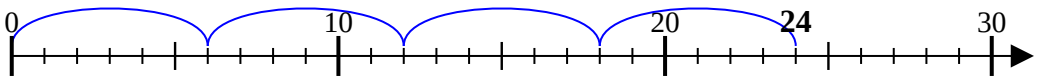

2) 16÷8=

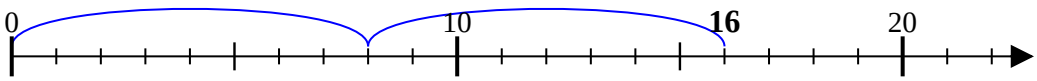

3) 10÷2=

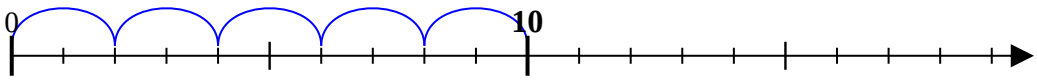

4) 40÷8=

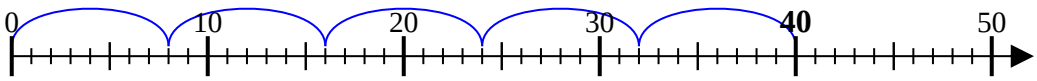

5) 6÷2=

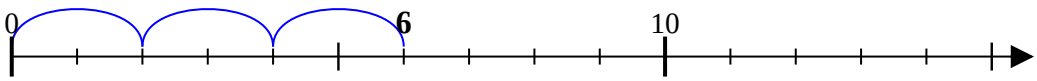

6) 40÷10=

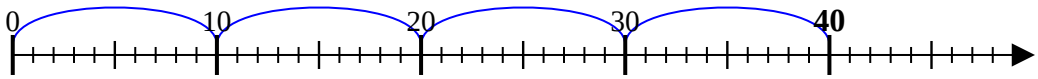

7) 15÷3=

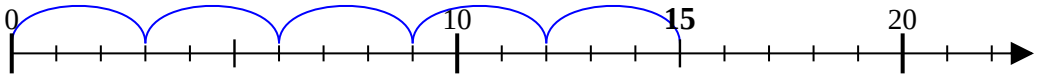

8) 18÷9=

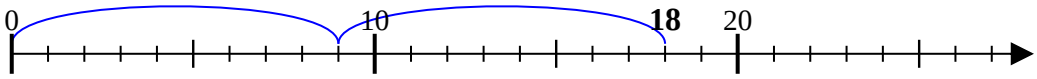

9) 27÷9=

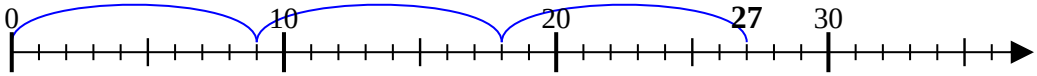

10) 36÷9=

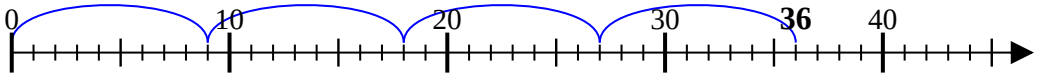

11) 8÷4=

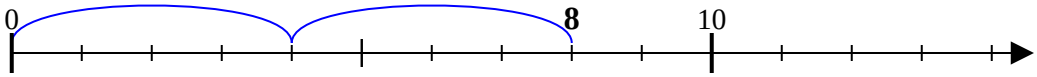

Answers

1. 4
2. 2
3. 5
4. 5
5. 3
6. 4
7. 5
8. 2
9. 3
10. 4
11. 2

1-10	91	82	73	64	55	45	36	27	18	9
11	0									