Completing and Matching Volume Equations Name:

Match each problem with the equation that could represent it. Answer with the missing term and letter.

Ex) 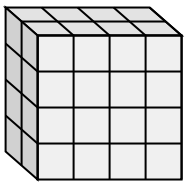

1) 

2) 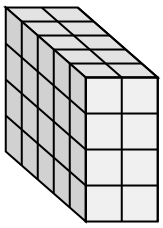

3) 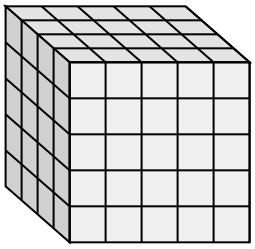

4) 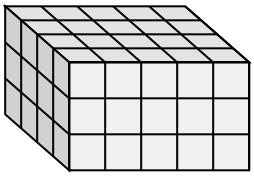

5) 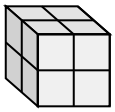

6) 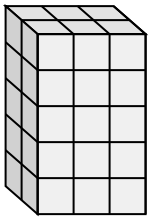

7) 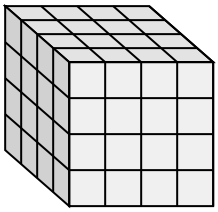

8) 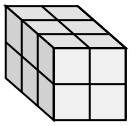

9) 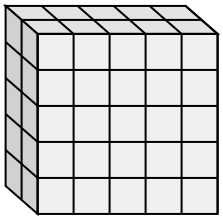

10) 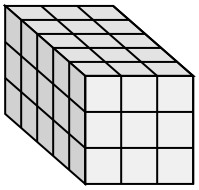

11) 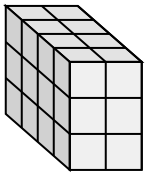

A. 4 × 5 × 3 = ___

B. 4 × ___ × 3 = 24

C. 2 × 3 × 5 = ___

D. ___ × 2 × 2 = 12

E. ___ × 5 × 5 = 50

F. ___ × 3 × 3 = 45

G. 5 × ___ × 4 = 40

H. 5 × 3 × 5 = ___

I. 4 × ___ × 4 = 64

J. 2 × ___ × 4 = 32

K. 4 × ___ × 5 = 100

L. 2 × ___ × 2 = 8

Answers

Ex. J , 4

1. _____
2. _____
3. _____
4. _____
5. _____
6. _____
7. _____
8. _____
9. _____
10. _____
11. _____

1-10	91	82	73	64	55	45	36	27	18	9
11	0									

Completing and Matching Volume Equations Name: **Answer Key**

Match each problem with the equation that could represent it. Answer with the missing term and letter.

Ex) 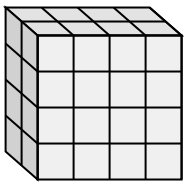

1) 

2) 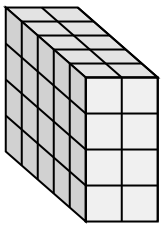

3) 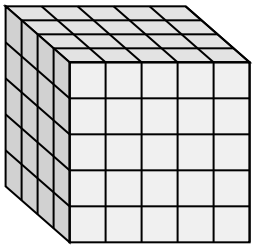

4) 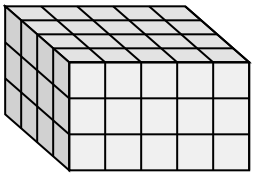

5) 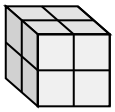

6) 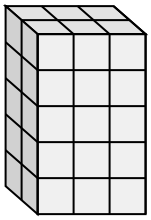

7) 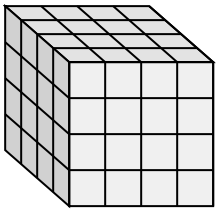

8) 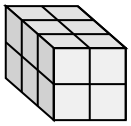

9) 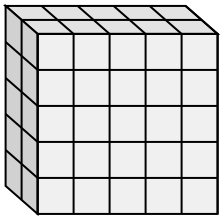

10) 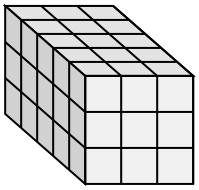

11) 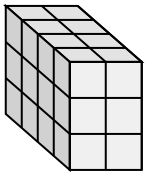

A. 4 × 5 × 3 = ___

B. 4 × ___ × 3 = 24

C. 2 × 3 × 5 = ___

D. ___ × 2 × 2 = 12

E. ___ × 5 × 5 = 50

F. ___ × 3 × 3 = 45

G. 5 × ___ × 4 = 40

H. 5 × 3 × 5 = ___

I. 4 × ___ × 4 = 64

J. 2 × ___ × 4 = 32

K. 4 × ___ × 5 = 100

L. 2 × ___ × 2 = 8

Answers

Ex.	J , 4
1.	H , 75
2.	G , 2
3.	K , 5
4.	A , 60
5.	L , 2
6.	C , 30
7.	I , 4
8.	D , 3
9.	E , 2
10.	F , 5
11.	B , 2

1-10	91	82	73	64	55	45	36	27	18	9
11	0									