Completing and Matching Volume Equations Name:

Match each problem with the equation that could represent it. Answer with the missing term and letter.

Ex) 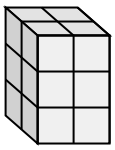

1) 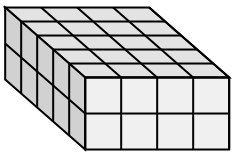

2) 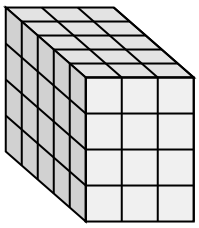

3) 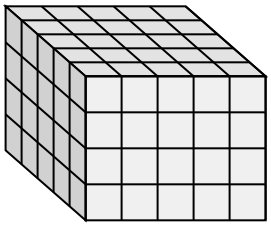

4) 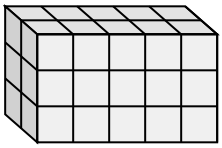

5) 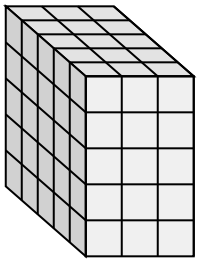

6) 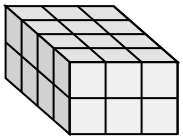

7) 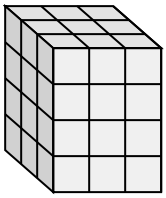

8) 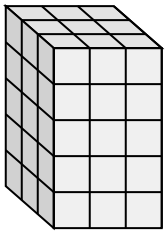

9) 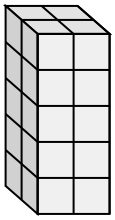

10) 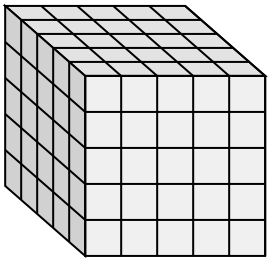

11) 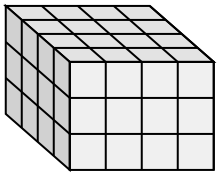

A. ___ × 2 × 5 = 20

B. 5 × ___ × 5 = 125

C. 2 × 2 × ___ = 12

D. 3 × 3 × ___ = 45

E. 3 × ___ × 4 = 36

F. 5 × 4 × ___ = 40

G. 4 × ___ × 2 = 24

H. ___ × 5 × 4 = 100

I. 2 × ___ × 3 = 30

J. ___ × 4 × 3 = 48

K. ___ × 3 × 4 = 60

L. 5 × 3 × 5 = ___

Answers

Ex. C , 3

1. _____
2. _____
3. _____
4. _____
5. _____
6. _____
7. _____
8. _____
9. _____
10. _____
11. _____

1-10	91	82	73	64	55	45	36	27	18	9
11	0									

Completing and Matching Volume Equations Name: **Answer Key**

Match each problem with the equation that could represent it. Answer with the missing term and letter.

Ex) 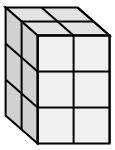

1) 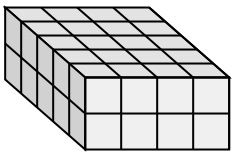

2) 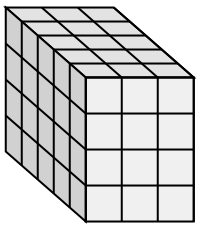

3) 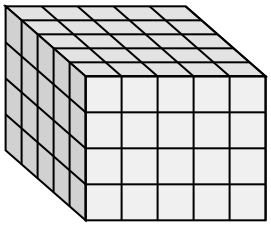

4) 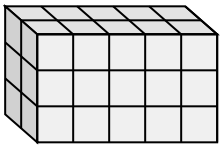

5) 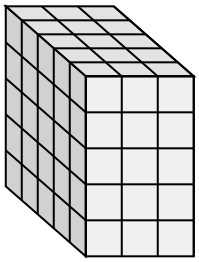

6) 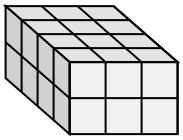

7) 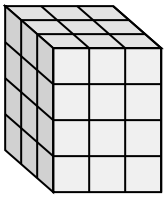

8) 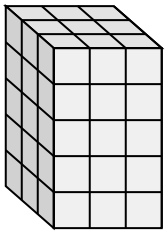

9) 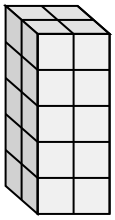

10) 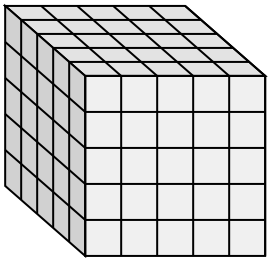

11) 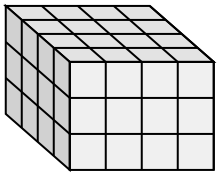

A. ___ × 2 × 5 = 20

B. 5 × ___ × 5 = 125

C. 2 × 2 × ___ = 12

D. 3 × 3 × ___ = 45

E. 3 × ___ × 4 = 36

F. 5 × 4 × ___ = 40

G. 4 × ___ × 2 = 24

H. ___ × 5 × 4 = 100

I. 2 × ___ × 3 = 30

J. ___ × 4 × 3 = 48

K. ___ × 3 × 4 = 60

L. 5 × 3 × 5 = ___

Answers

Ex.	C , 3
1.	F , 2
2.	K , 5
3.	H , 5
4.	I , 5
5.	L , 75
6.	G , 3
7.	E , 3
8.	D , 5
9.	A , 2
10.	B , 5
11.	J , 4

1-10	91	82	73	64	55	45	36	27	18	9
11	0									